姓名 _____

练习
10-2

数百位、十位和个位

用位值方块和表格写数字。

1.

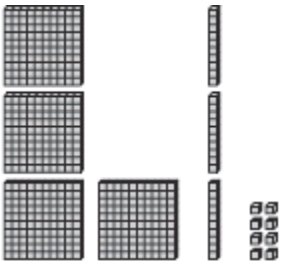

百位	十位	个位
4	3	8

2.



百位	十位	个位

3.



百位	十位	个位

4.



百位	十位	个位

5. 推理 Kyra根据位值方块写出 **78** 。



她犯了什么错误?

_____

哪一个是正确的数字?

87	708	780	807
Ⓐ	Ⓑ	Ⓒ	Ⓓ

Copyright © Pearson Education, Inc., or its affiliates. All Rights Reserved. 2